www.Educate-UK.net

AQA

Please write clearly in block capitals.

Centre number | | | | | | Candidate number | | | | |

Surname _____

Forename(s) _____

Candidate signature _____
I declare this is my own work.

GCSE
MATHEMATICS

F

Foundation Tier Paper 2 Calculator

Time allowed: 1 hour 30 minutes

Materials

For this paper you must have:
- a calculator
- mathematical instruments.

Instructions

- Use black ink or black ball-point pen. Draw diagrams in pencil.
- Fill in the boxes at the top of this page.
- Answer **all** questions.
- You must answer the questions in the spaces provided. Do not write outside the box around each page or on blank pages.
- If you need extra space for your answer(s), use the lined pages at the end of this book. Write the question number against your answer(s).
- Do all rough work in this book. Cross through any work you do not want to be marked.

Information

- The marks for questions are shown in brackets.
- The maximum mark for this paper is 80.
- You may ask for more answer paper, graph paper and tracing paper. These must be tagged securely to this answer book.

Advice

In all calculations, show clearly how you work out your answer.

For Examiner's Use	
Pages	Mark
2–3	
4–5	
6–7	
8–9	
10–11	
12–13	
14–15	
16–17	
18–19	
20–21	
22–23	
24–25	
TOTAL	

www.Educate-UK.net

Do not write outside the box

Answer **all** questions in the spaces provided.

1 Circle the factor of 32

[1 mark]

16 12 3 64

2 y is 3 more than x.

Circle the correct equation.

[1 mark]

$y = 3x$ $y = x + 3$ $y = x - 3$ $y = \frac{x}{3}$

3 Circle the value of 0.15 as a fraction.

[1 mark]

$\frac{1}{5}$ $\frac{1}{6}$ $\frac{3}{20}$ $\frac{3}{50}$

www.Educate-UK.net

Do not write outside the box

4 Here is a parallelogram.

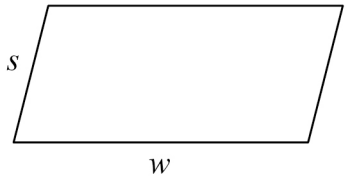

Circle the expression for the **perimeter**.

[1 mark]

$2s + 2w$ $\quad$ $s + w$ $\quad$ sw $\quad$ $2sw$

5 Work out the value of $a^2 - 4a$ when $a = 10$

[2 marks]

Answer _____

Turn over for the next question

6

www.Educate-UK.net

Do not write outside the box

6 16 people were asked to name their favourite fruit juice.

Here are the results.

Favourite juice	Frequency
Apple	6
Grapefruit	1
Orange	4
Mango	5

6 (a) One of the people was picked at random.

Work out the probability that their favourite juice was orange **or** mango.

[1 mark]

Answer _____

6 (b) On the grid, draw a bar chart to represent the results.

[3 marks]

Favourite juice



www.Educate-UK.net

Do not write outside the box

7 6 cakes cost £10.74

Work out the cost of 11 of these cakes.

[2 marks]

Answer £ _____

8 Here is a cuboid.

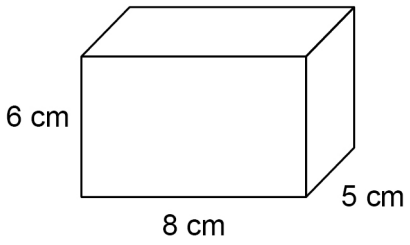

Work out the volume.

[1 mark]

Answer _____ cm^3

7

Turn over ►

www.Educate-UK.net

Do not write outside the box

9 Work out two numbers that

are multiples of 9

and

have a difference of 54

[2 marks]

Answer _____ and _____

10 Convert 11.2 kilometres into miles.

Use 8 km = 5 miles

[2 marks]

Answer _____ miles

www.Educate-UK.net

Do not write outside the box

11 Annie spends these amounts in four shops using £20 notes, £10 notes and £5 notes.

Shop A	£65
Shop B	£40
Shop C	£115
Shop D	£75

In each shop she

pays the exact amount

uses the **smallest** possible number of notes.

Work out the total number of each note she uses.

[3 marks]

Number of £20 notes _____

Number of £10 notes _____

Number of £5 notes _____

7

www.Educate-UK.net

Do not write outside the box

12 A sports team played 40 games.

Half were home games and half were away games.

Each game was a win, a draw or a loss.

Of the **home** games, $\frac{2}{5}$ were losses.

Of the **away** games, $\frac{1}{10}$ were wins.

12 (a) Complete the frequency tree.

[4 marks]

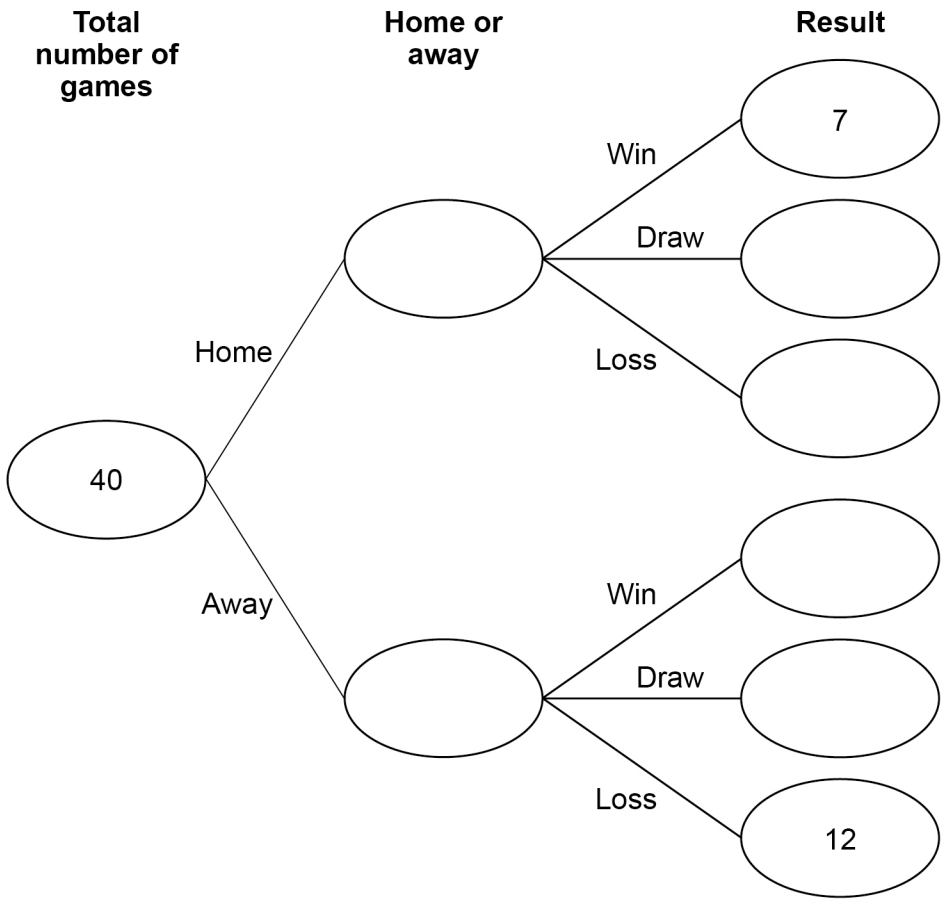

www.Educate-UK.net

Do not write outside the box

12 (b) The team gets

6 points for a win

3 points for a draw

0 points for a loss.

Work out the **total** number of points that the team got.

[2 marks]

Answer _____

13 Factorise fully $50x + 100$

[2 marks]

Answer _____

8

Turn over ►

www.Educate-UK.net

Do not write outside the box

14 Some buttons are red or blue in the ratio red : blue = 3 : 5

What fraction of the buttons are red?

Circle your answer.

[1 mark]

$\frac{2}{5}$ $\frac{3}{5}$ $\frac{3}{8}$ $\frac{5}{8}$

15 Which of these is a correct statement about a cube?

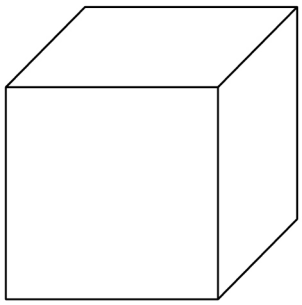

Tick **one** box.

[1 mark]

☐ It has 12 edges.

☐ It has 12 faces.

☐ It has 12 planes.

☐ It has 12 vertices.

www.Educate-UK.net

Do not write outside the box

16 *AB* is parallel to *CD*.

FG is a straight line.

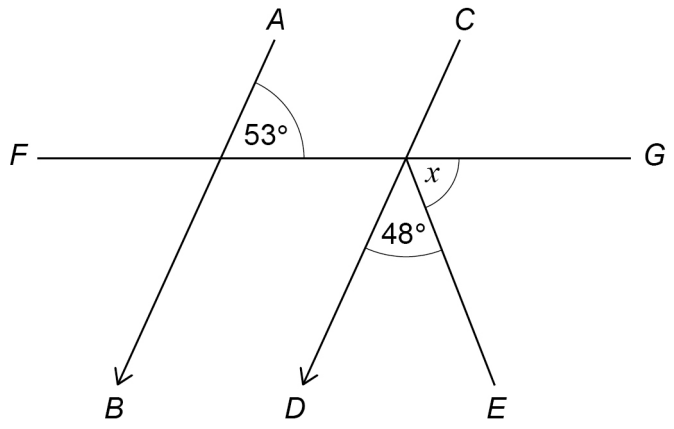

Not drawn accurately

Work out the size of angle x.

[3 marks]

Answer _____ degrees

5

Turn over ►

www.Educate-UK.net

Do not write outside the box

17 Harry and his sister Jess have some money in the ratio Harry : Jess = 1 : 4

Harry has £7.35

They pay £16.99 for a present for a friend.

Harry uses $\frac{1}{3}$ of his money.

Jess pays the rest.

How much money does Jess have left?

[4 marks]

Answer £ _____

www.Educate-UK.net

Do not write outside the box

18 Solve $10x - 3 = 21$

[2 marks]

$x =$ _____

19 Work out which of these fractions is closer in value to 0.5

$$\frac{5}{16} \qquad \frac{17}{25}$$

You **must** show your working.

[2 marks]

Answer _____

8

Turn over ►

www.Educate-UK.net

Do not write outside the box

20 (a) Point *B* is 400 metres north east of point *A*.

Mark point *B* on the centimetre grid.

Use a scale of 1 centimetre represents 100 metres.

[2 marks]

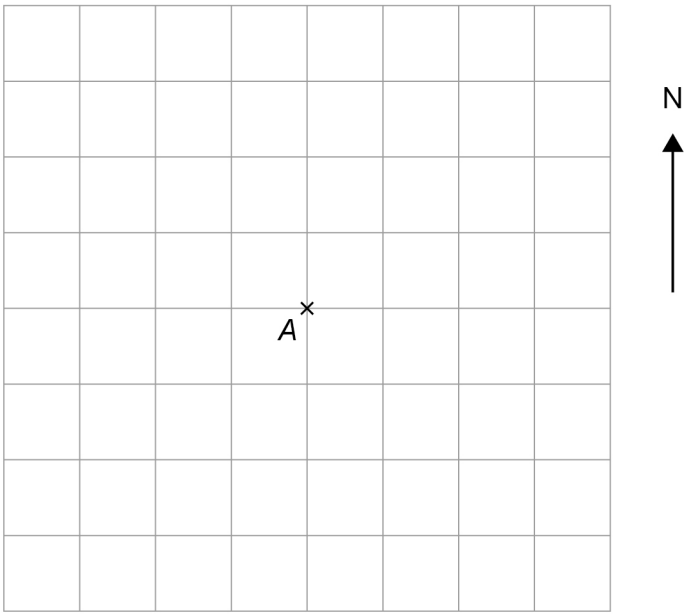

www.Educate-UK.net

Do not write outside the box

Points *C* and *D* are shown on a different centimetre grid.

Scale: 1 : 1000

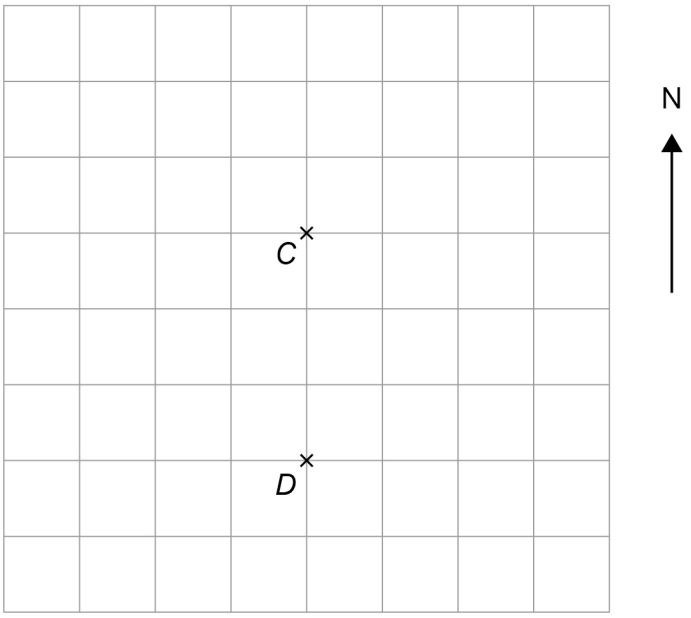

20 (b) Work out the bearing of *D* from *C*.

[1 mark]

Answer _____ °

20 (c) Work out the actual distance, in metres, of *D* from *C*.

Use the scale 1 : 1000

[1 mark]

_____

_____

_____

Answer _____ metres

4

Turn over ►

www.Educate-UK.net

Do not write outside the box

21 Lynn works as a bus driver.

She is paid £10.80 per hour for the first 38 hours she works each week.

She is paid 25% **more** per hour for each extra hour she works.

One week, Lynn was paid £491.40

In total, how many hours did she work that week?

You **must** show your working.

[5 marks]

Answer _____ hours

www.Educate-UK.net

Do not write outside the box

22 The square root of x is 4

Circle the value of x^2

[1 mark]

256 2 16 8

23 Here is a rule for a sequence.

After the first two terms, each term is the sum of the previous two terms.

The first five terms are p 23 q 57 r

Work out the values of p, q and r.

[2 marks]

$p =$ _____

$q =$ _____

$r =$ _____

8

Turn over ►

www.Educate-UK.net

Do not write outside the box

24 Here is triangle *ABC*.

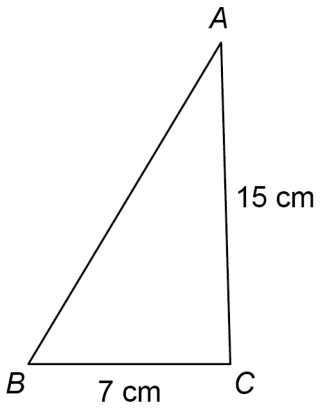

Not drawn accurately

24 (a) Assume that angle $ACB = 90°$

Work out the length *AB*.

[3 marks]

Answer _____ cm

www.Educate-UK.net

Do not write outside the box

24 (b) The actual length *AB* is greater than the answer to part (a).

What does this mean about angle *ACB*?

Tick **one** box.

[1 mark]

☐ It is 90°

☐ It is less than 90°

☐ It is more than 90°

☐ It could be any of the above.

25 Rearrange $g = 3h - 1$ to make h the subject.

[2 marks]

Answer _____

6

Turn over ►

www.Educate-UK.net

Do not write outside the box

26

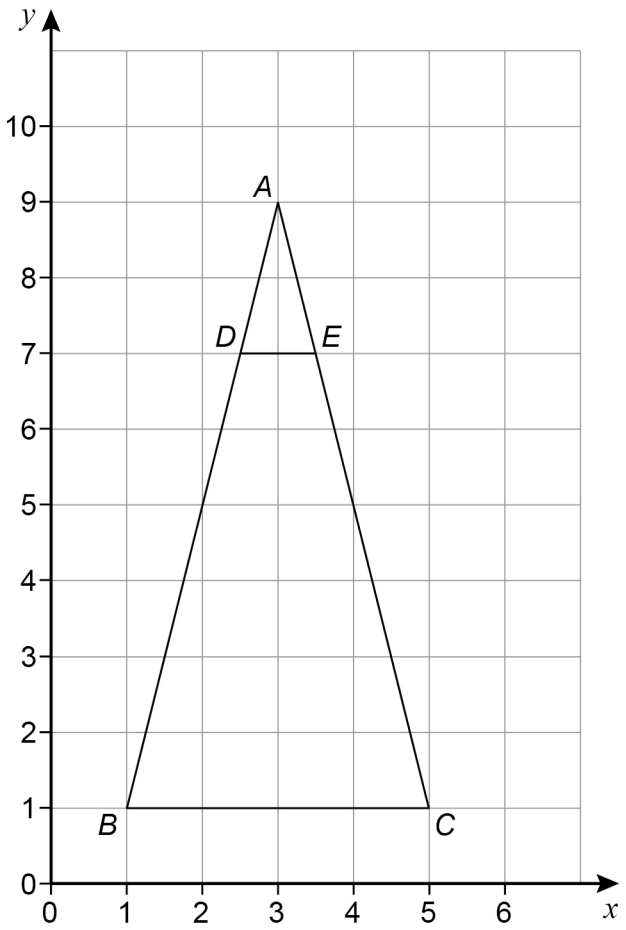

Describe fully the **single** transformation that maps triangle *ABC* to triangle *ADE*.

[3 marks]

www.Educate-UK.net

Do not write outside the box

27 A ball contains 5000 cm^3 of air.

More air is pumped into the ball at a rate of 160 cm^3 per second.

The ball is full of air when it becomes a sphere with radius 15 cm

Volume of a sphere $= \frac{4}{3}\pi r^3$ where r is the radius

Does it take **less than** 1 minute to fill the ball?

You **must** show your working.

[4 marks]

7

Turn over ►

www.Educate-UK.net

Do not write outside the box

28 p is a positive number.

n is a negative number.

For each statement, tick the correct box.

[4 marks]

	Always true	Sometimes true	Never true
$p + n$ is positive			
$p - n$ is positive			
$p^2 + n^2$ is positive			
$p^3 \div n^3$ is positive			

www.Educate-UK.net

Do not write outside the box

29 250 trains arrived at a station.

The number of trains that were late was recorded after every 50 trains.

The table shows some information about the results.

Total number of trains	50	100	150	200	250
Total number of late trains	16	21	36	38	55
Relative frequency of late trains	0.32	0.21			

29 (a) Complete the relative frequency graph.

[3 marks]

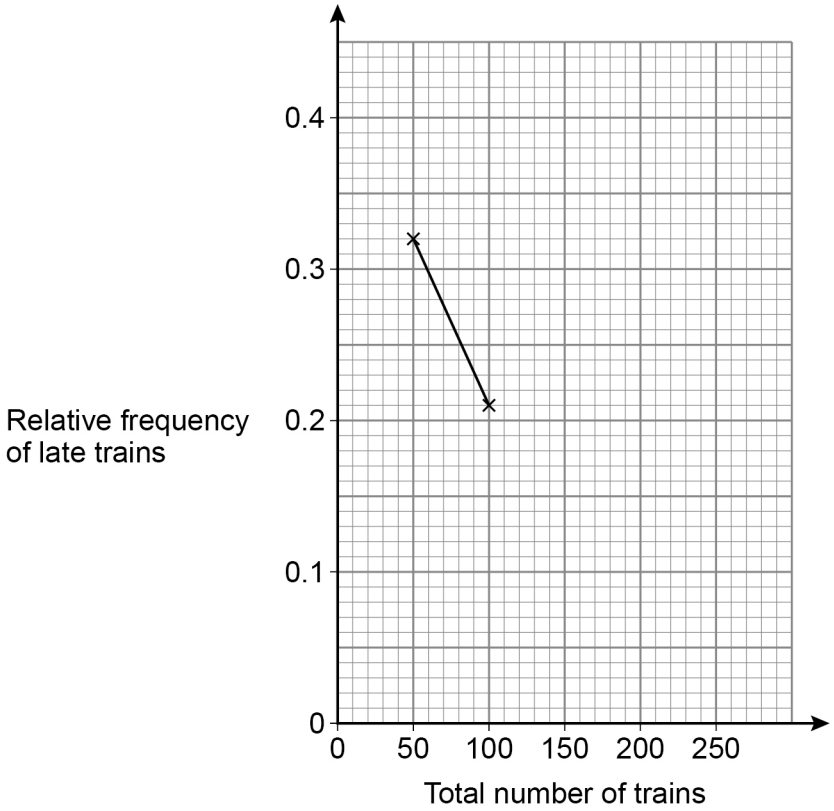

29 (b) Write down the best estimate of the probability that a train arriving at the station is late.

[1 mark]

Answer _____

8

Turn over ►

www.Educate-UK.net

Do not write outside the box

30 *A*, *B* and *C* are three points on a circle.

The radii from *A*, *B* and *C* are shown.

Not drawn accurately

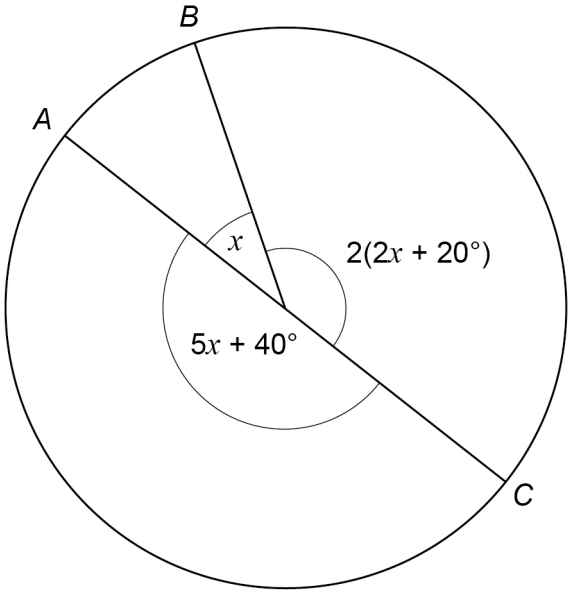

Is *AC* a diameter of the circle?

You **must** show your working.

[3 marks]

www.Educate-UK.net

Do not write outside the box

31 A straight line

has gradient 6

and

passes through the point (3, 19)

Work out the equation of the line.

Give your answer in the form $y = mx + c$

[3 marks]

Answer _____

END OF QUESTIONS

6

www.Educate-UK.net

Do not write outside the box

There are no questions printed on this page

DO NOT WRITE ON THIS PAGE
ANSWER IN THE SPACES PROVIDED

www.Educate-UK.net

Do not write outside the box

Question number	**Additional page, if required.** **Write the question numbers in the left-hand margin.**

www.Educate-UK.net

Do not write outside the box

Question number	**Additional page, if required.** **Write the question numbers in the left-hand margin.**

Copyright information

For confidentiality purposes, all acknowledgements of third-party copyright material are published in a separate booklet. This booklet is published after each live examination series and is available for free download from www.aqa.org.uk.

Permission to reproduce all copyright material has been applied for. In some cases, efforts to contact copyright-holders may have been unsuccessful and AQA will be happy to rectify any omissions of acknowledgements. If you have any queries please contact the Copyright Team.

Copyright © 2021 AQA and its licensors. All rights reserved.